Dé Máirt 5ú-Obair

Litriú: Cúige Laighean

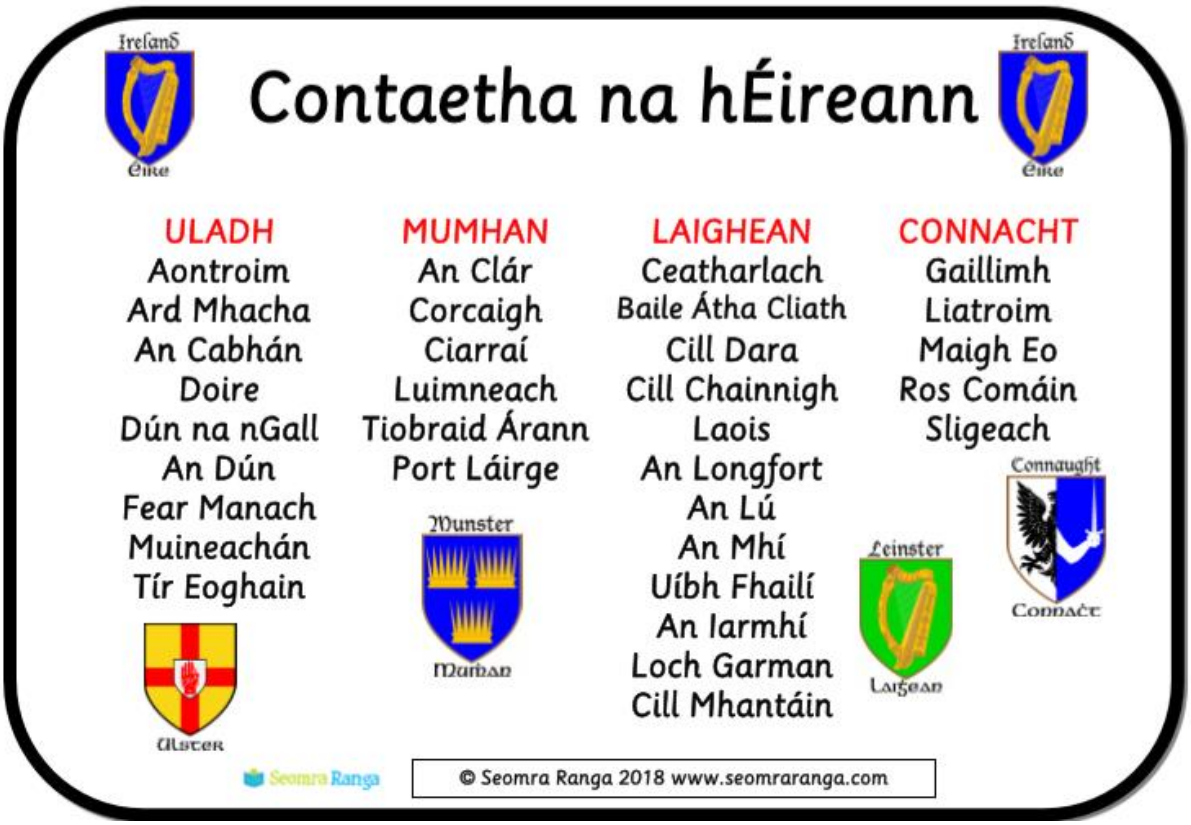

Táblaí

6 × 3 = _____	12 × 8 = _____	66 ÷ 11 = _____
96 ÷ 12 = _____	10 × 10 = _____	7 × 6 = _____
10 × 11 = _____	5 × 4 = _____	5 × 7 = _____
8 × 4 = _____	81 ÷ 9 = _____	9 × 10 = _____
88 ÷ 11 = _____	3 × 3 = _____	22 ÷ 11 = _____
72 ÷ 9 = _____	7 × 6 = _____	27 ÷ 3 = _____
24 ÷ 6 = _____	4 ÷ 2 = _____	2 × 9 = _____
11 × 9 = _____	1 × 4 = _____	5 × 11 = _____
11 × 11 = _____	11 × 10 = _____	10 × 5 = _____
12 × 7 = _____	10 × 12 = _____	4 × 12 = _____

Toilleadh – Millilítir agus lítir arís

1. Cé mhéad leachta atá i ngach crúiscín?

(a) Caoineog

____ ml

(b) Sú oráiste

____ ml

(c) Uisce

____ ml

(d) Sú cuiríní dubha

____ ml

(e) Cén leacht a bhfuil an toilleadh is lú aige? _____

(f) Cén leacht a bhfuil an toilleadh is mó aige? _____

(g) Cad é toilleadh iomlán an tsú oráiste agus an uisce? ____ ml

(h) Cé mhéad sú oráiste níos mó atá uait chun go mbeadh 1l ann? ____ ml

(i) Cé mhéad uisce níos lú ná caoineog atá ann? ____ ml

---

2. Cé mhéad millilítear leachta a ghlacann gach soitheach? Déan meastachán agus ansin tomhais go dtí an 50 millilítear is gaire. (Leid: Tá braon uisce thart ar 1ml.)

	Soitheach	Déan meastachán	Tomhais
(a)	Cupán		
(b)	Ubhchupán		
(c)	Babhla		
(d)	Gloine		
(e)	Cartán iogairt		

---

3. Cé acu is fearr chun toilleadh na rudaí seo thíos a thomhas: lítir nó millilítir?

(a)

_____

(b)

_____

(c)

_____

(d)

_____

English Version

Capacity – More millilitres and litres

1. How much liquid is there in each jug?

(a) Smoothie (b) Orange juice (c) Water (d) Blackcurrant

____ml ____ml ____ml ____ml

(e) Which liquid is there least of? _____

(f) Which liquid is there most of? _____

(g) What is the total measure of orange juice and water? ____ml

(h) How much more orange juice is needed to make 1l of juice? ____ml

(i) How much less water is there than the smoothie? ____ml

2. How many millilitres of liquid can each container hold? Estimate then measure to the nearest 50 millilitres. (Hint: A drop of water is about 1mL)

	Object	Estimate	Measure
(a)	Cup		
(b)	Egg cup		
(c)	Bowl		
(d)	Glass		
(e)	Yogurt carton		



3. Which is best for measuring the capacity of the following: **litres** or **millilitres**?

(a) (b) (c) (d)

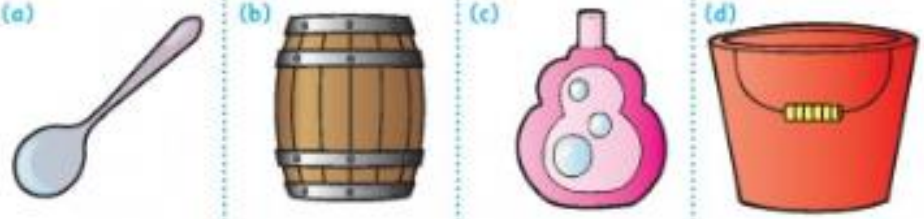

_____ _____ _____ _____

Pompeii agus Sliabh Vesuvius

Samhlaigh go bhfuil tú slán sábhailte trasna an fharraige ag féachaint ar Sliabh Vesuvius ag pléascadh . Imagine you are safely across the bay when Vesuvius erupts.

Cad a chloiseann tú? What can you hear?

Cad a fheiceann tú? What can you see?



Conas a mhothaíonn tá What can you feel?

Cén bolú a fhaigheann tú? What can you smell?